Date : _____ Name : _____

Score : _____

FRACTIONS WORKSHEET

Write the Fraction for the Shaded Parts

Example : = $\frac{2}{6}$

- Number of Shaded Parts
- Total Number of Equal Parts

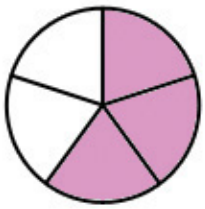 = ☐

= ☐

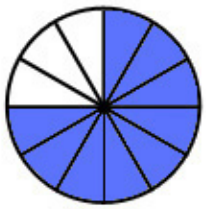 = ☐

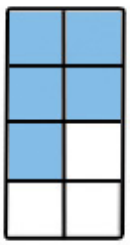 = ☐

= ☐

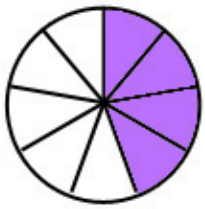 = ☐

= ☐

= ☐

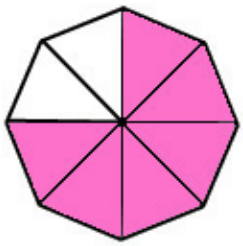 = ☐

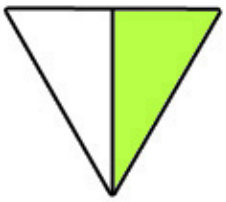 = ☐

= ☐

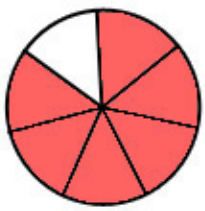 = ☐